Geometry

Unit 3 Theorem proofs C

Name:

Date: Period: 1 2 3 4 5 6

Standards: 7.0. 16.0 Holt: 3.3 p. 163

1. Given: $l \parallel m$

   Prove: $\angle 1$ and $\angle 2$ are supplementary

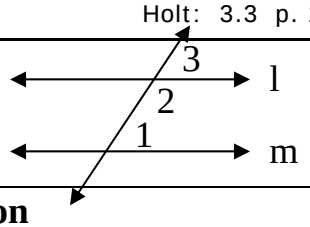

Statement	Reason

2. Given: $l \parallel m$

   Prove: $\angle 7$ and $\angle 8$ are supplementary

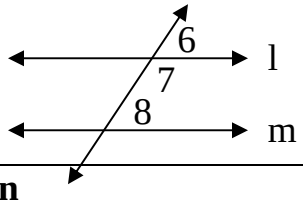

Statement	Reason

3. Given: $l \parallel m$

   Prove: $\angle 3$ and $\angle 4$ are supplementary

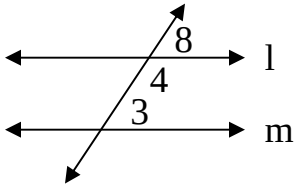

Statement	Reason