Geometry

Unit 3 Proving Theorems D

Name:

Date: Period: 1 2 3 4 5 6

1. Given: $l \parallel m$

   Prove: $\angle 1 \cong \angle 3$

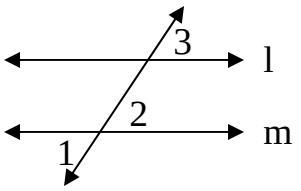

Statement	Reason

2. Given: $l \parallel m$

   Prove: $\angle 7 \cong \angle 8$

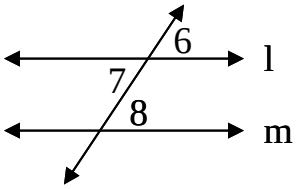

Statement	Reason

3. Given: $l \parallel m$

   Prove: $\angle 3$ and $\angle 4$ are supplementary

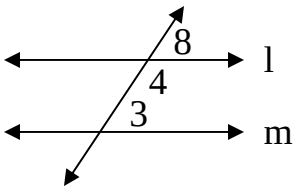

Statement	Reason